

7	Draw the Ortho projection of given objects in 3 views (FV, TV, SV Respectively). [14M] 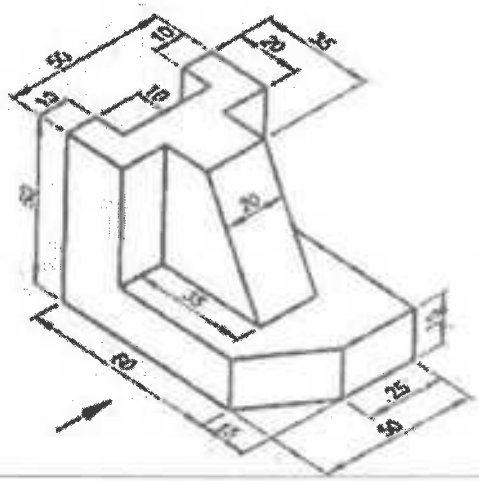	4	L2
	OR		
8	A circle of 50 mm diameter rolls on another circle of radius 60mm for one revolution. Trace the path of the curve. [14 M]	4	L2
9	The end A of a line AB is 20mm above and 30mm infront of V.P, While the end B is 50mm above and 55mm infront of V.P. The distance between projectors are 60mm apart Draw the projections and determine its inclinations. [14 M]	5	L2
	OR		
10	Draw the Isometric Projections for the following figures. [14 M] 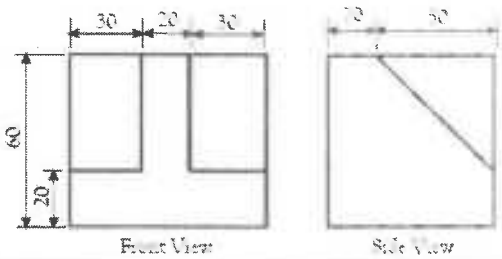	5	L2